Prénom : .....

Date : .....

Cachet / commentaire

Les additions jusqu'à 10

Compte les fruits. Écris le total.







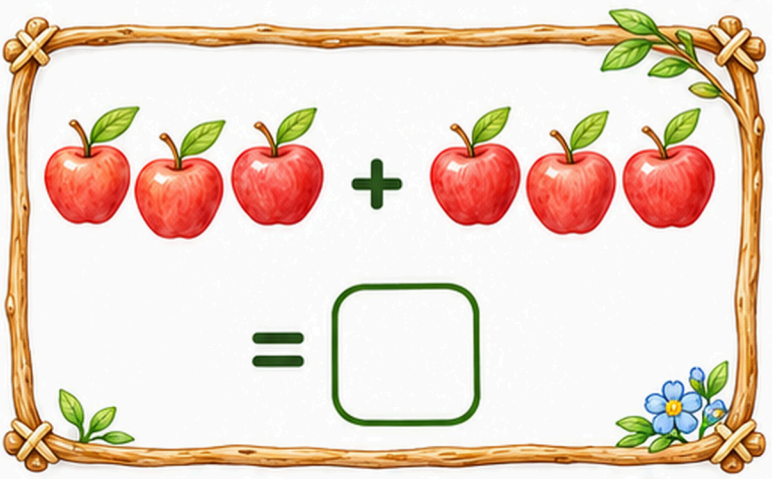







Les dominos de Croco

Compte les points. Écris l'addition.



□ + □ = □



□ + □ = □



□ + □ = □



□ + □ = □



□ + □ = □



□ + □ = □



□ + □ = □



□ + □ = □

Les bonds de la grenouille

Place le point de départ. Dessine les bonds.

Exemple

$2 + 1 = 3$

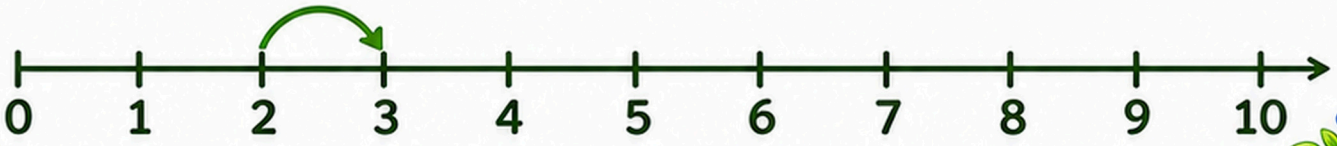

$3 + 2 = \square$



$4 + 3 = \square$



$6 + 2 = \square$

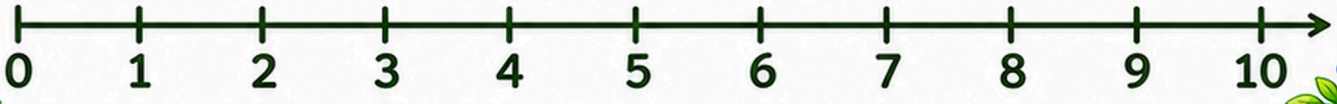

$5 + 4 = \square$

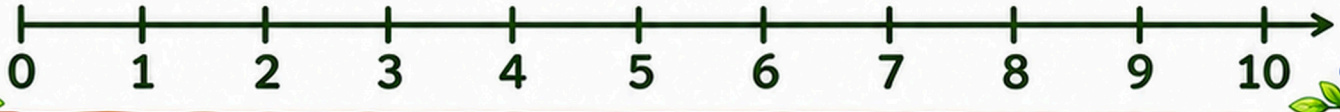

$7 + 3 = \square$

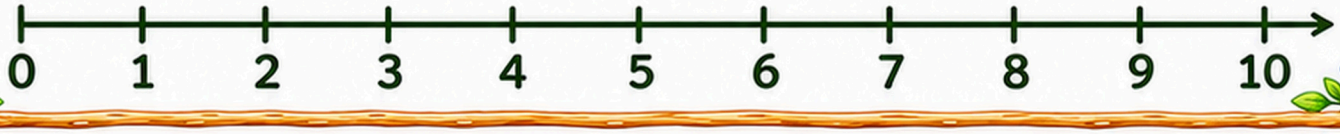

Le jardin des doubles

Dessine autant de fleurs de l'autre côté. Complète.



1 + ☐ = ☐



2 + ☐ = ☐



3 + ☐ = ☐



4 + ☐ = ☐

Calcule.

5 + 5 = ☐

2 + 2 = ☐

4 + 4 = ☐

3 + 3 = ☐

Les amis de 10

Dessine les jetons, un par case. Compte les cases vides.

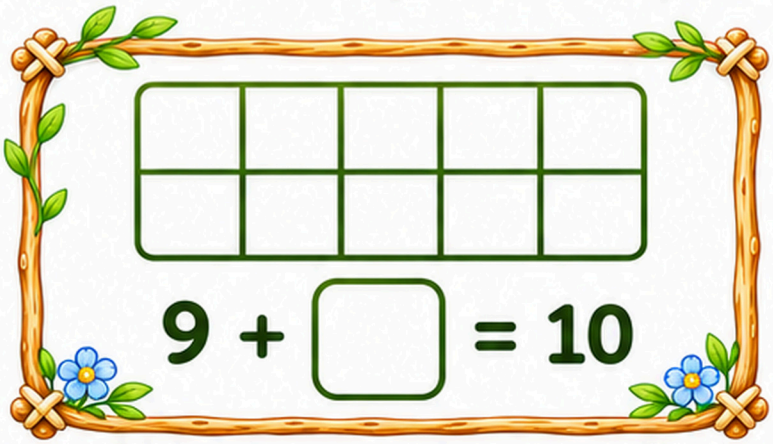

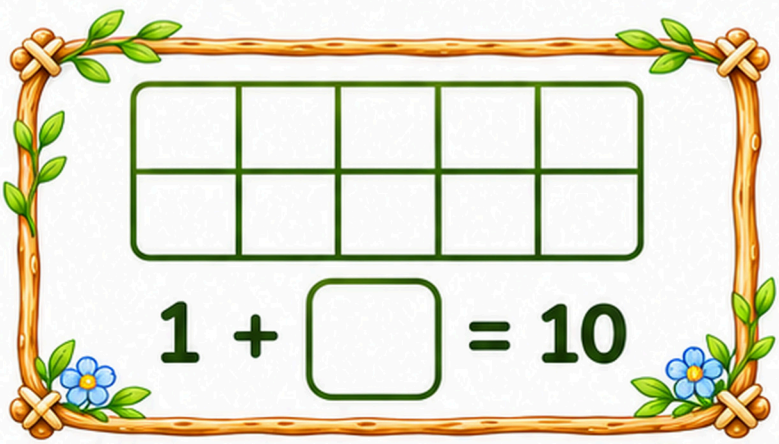

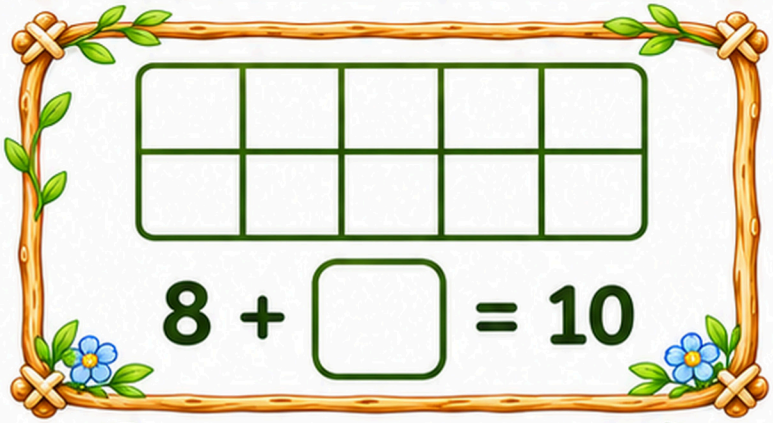

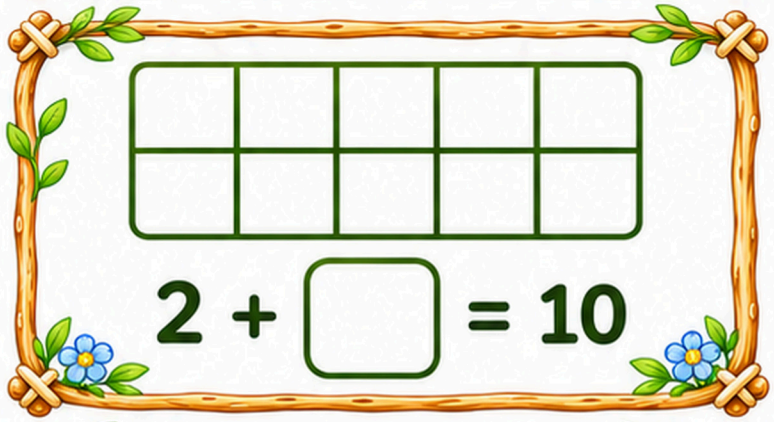

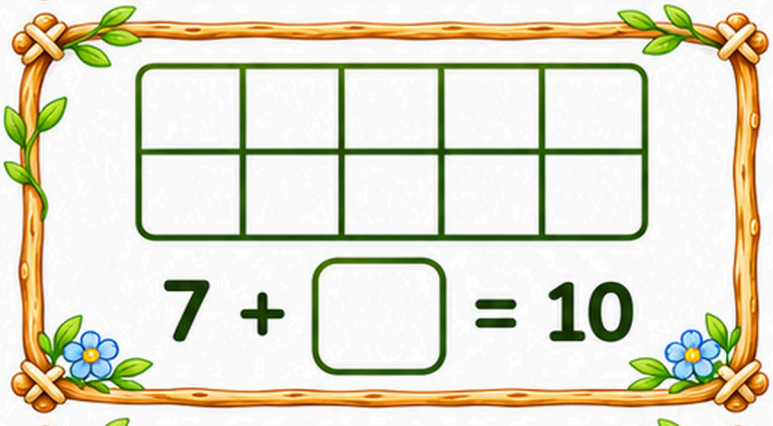

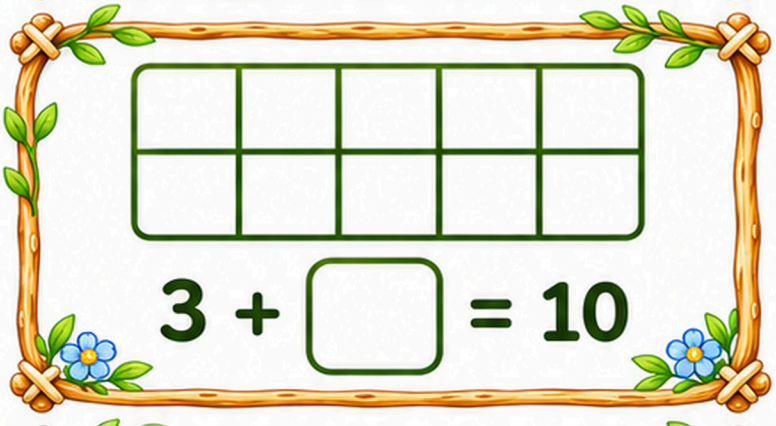

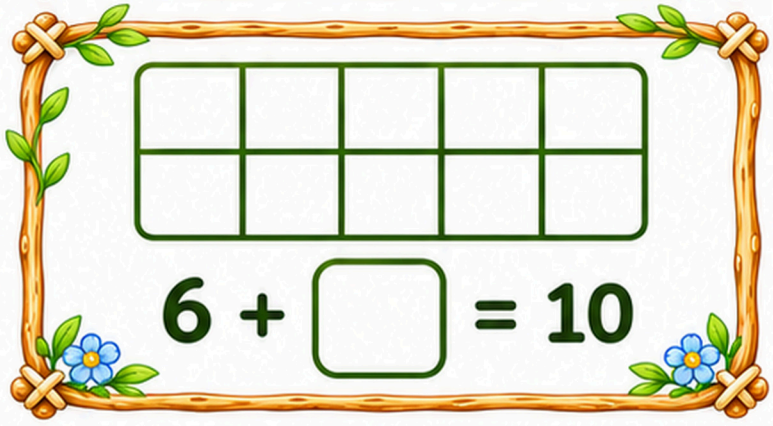

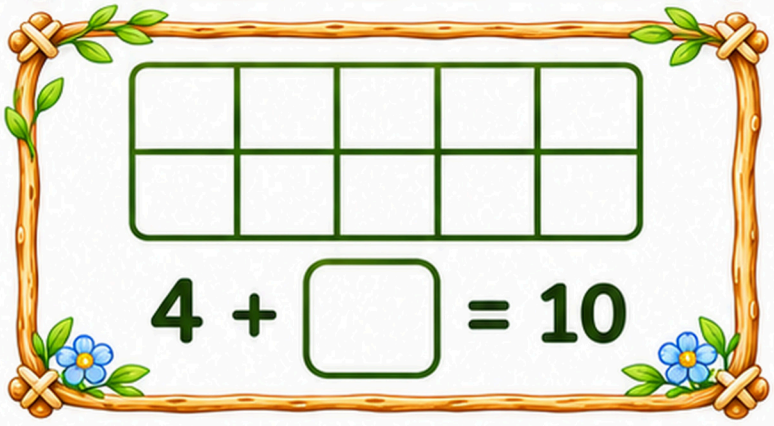



Le nombre caché

Trouve le nombre qui manque.

Exemple

$2 + \square = 3 \rightarrow 2 + 1 = 3$

$1 + \square = 4$

$2 + \square = 5$

$3 + \square = 7$

$4 + \square = 6$

$5 + \square = 9$

$\square + 2 = 6$

$\square + 3 = 8$

$\square + 1 = 9$

$\square + 4 = 10$

$\square + 5 = 10$

Trois petits groupes



Additionne les deux premiers nombres, puis le troisième.

$$\underbrace{2 + 1}_{3} + 2 = 5$$

$1 + 1 + 2 = \square$

$2 + 2 + 1 = \square$

$3 + 1 + 2 = \square$

$2 + 3 + 2 = \square$

$4 + 2 + 3 = \square$

$3 + 3 + 4 = \square$

Les défis du jardin

Écoute. Dessine. Écris l'addition.

Croco a 3 pommes.
Lila lui en donne 2.
Combien en a-t-il ?

☐ + ☐ = ☐

Lila plante 4 roses et 2 tulipes.
Combien de fleurs
plante-t-elle ?

☐ + ☐ = ☐

Il y a 3 canards,
4 autres arrivent.
Combien y en a-t-il ?

☐ + ☐ = ☐

Croco trouve 5 noix,
puis encore 3.
Combien en a-t-il ?

☐ + ☐ = ☐

Lila cueille 4 poires.
Croco en cueille 5.
Combien en ont-ils en tout ?

☐ + ☐ = ☐

Croco a 6 graines.
Il en reçoit 4.
Combien en a-t-il ?

☐ + ☐ = ☐

Autoévaluation

Cette matière est :



SuperCroco.com